# Digitale tyd oggend

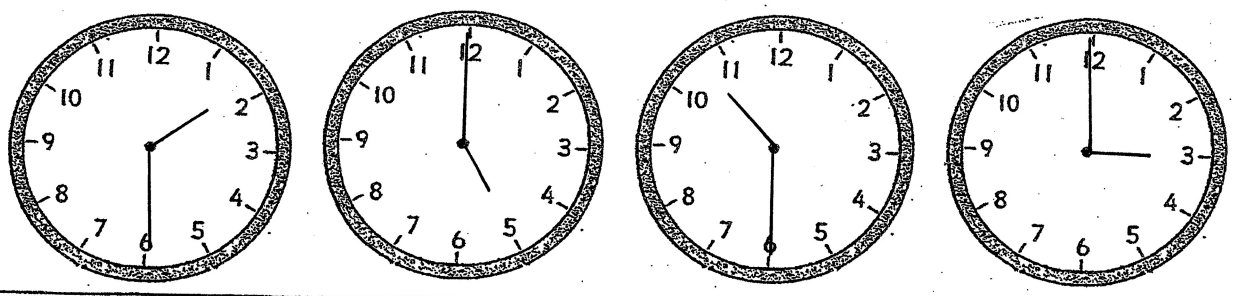

| | | | |
|---|---|---|---|
| 1:30 vm | 5:00 vm | 10:30 vm | 3:00 vm |

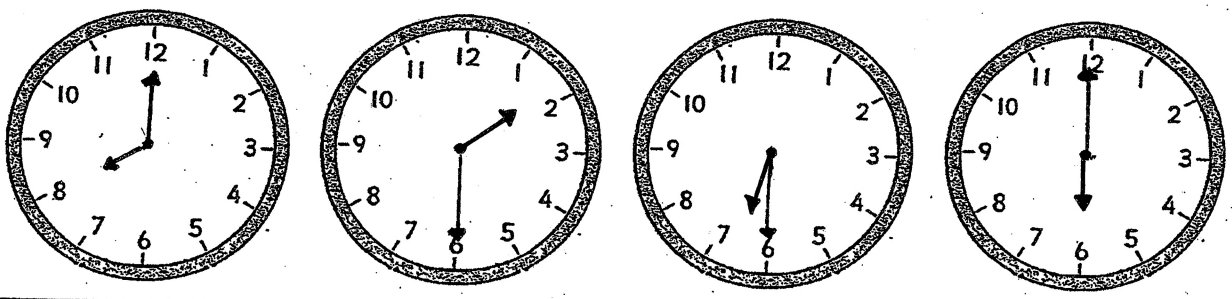

| | | | |
|---|---|---|---|
| 8:00 vm | 1:30 vm | 6:30 vm | 6:00 vm |

# Digitale tyd - middag/aand

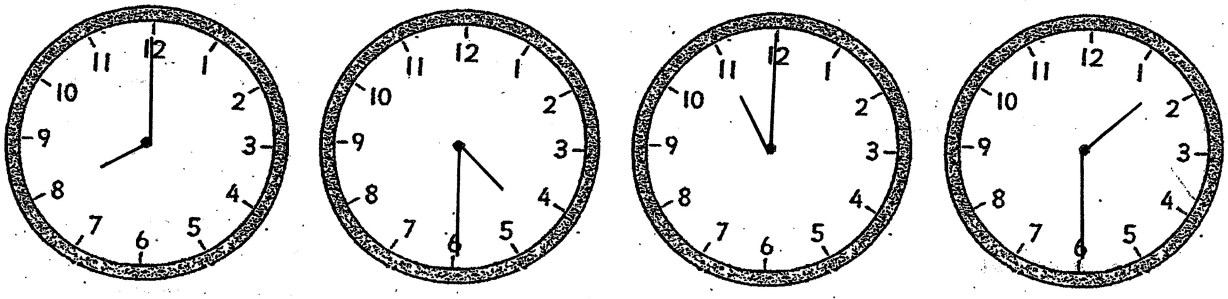

| | | | |
|---|---|---|---|
| 8:00 nm | 4:30 nm | 11:00 nm | 1:30 nm |

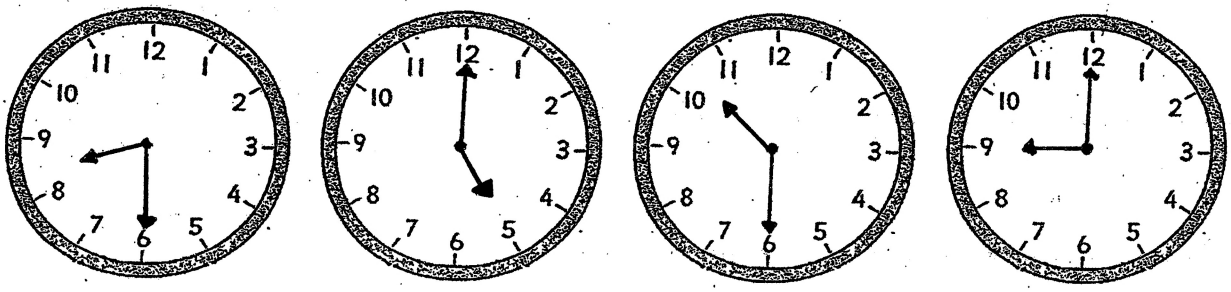

| | | | |
|---|---|---|---|
| 8:30 nm | 5:00 nm | 10:30 nm | 9:00 nm |

Werkvel 3

## Kombinasies

Werkvel 4

| | | | |
|---|---|---|---|
| 7 + 4 = 11 | 17 − 6 = 11 | 6 + 10 = 16 | 14 − 7 = 7 |
| 20 − 5 = 15 | 10 + 4 = 14 | 16 − 9 = 7 | 9 + 8 = 17 |
| 8 + 5 = 13 | 17 − 5 = 12 | 14 + 3 = 17 | 13 − 8 = 5 |
| 19 − 12 = 7 | 12 + 2 = 14 | 14 − 5 = 9 | 4 + 15 = 19 |

## Treintjiesomme

| | | |
|---|---|---|
| 4 + 5 + 10 = 19 | 10 − 5 − 3 = 2 | 5 + 6 + 6 = 17 |
| 18 − 3 − 4 = 11 | 5 + 7 + 6 = 18 | 13 − 4 − 3 = 6 |
| 3 + 5 + 11 = 19 | 12 − 4 − 8 = 0 | 6 + 1 + 8 = 15 |
| 16 − 8 − 4 = 4 | 4 + 6 + 7 = 17 | 14 − 7 − 4 = 3 |

## Geldsomme

Ek koop 'n vrug van R6,50 en 'n kar van R5,50. Hoeveel kos dit altesaam?

R6.50 + R5.50

R6 + R5 → R11 + R1 = R12

Ek koop 'n bal van R15,50. Ek betaal met R20. Hoeveel kleingeld kry ek?

R20 − R15.50

R20 − R15 → R5 − 50c = R4.50

Ek koop 'n pop van R9,50 en 'n rokkie van R7,50. Hoeveel kos dit altesaam?

R9.50 + R7.50

R9 + R7 → R16 + R1 = R17

Ek koop 'n sak van R1,50. Ek betaal met R5. Hoeveel kleingeld kry ek?

R5 − R1.50

R5 − R1 → R4 − 50c = R3.50

## Werkvel 6

Klanke: -rm

| | |
|---|---|
| poparm | vuurwarm |
| erdwurm | kermkous |
| dunderm | byswerm |
| reënstorm | valskerm |
| huisalarm | darem |

## Werkvel 7

Phonics: th-

| | |
|---|---|
| think | thick |
| there | thin |
| them | they |
| this | thief |
| that | bath |

Sentence: I have three sweets in my hand.

| | | | | |
|---|---|---|---|---|
| 16 | | | | |
| 26 | 27 | | | |
| 36 | 37 | 38 | | |
| 46 | 47 | 48 | 49 | |
| 56 | 57 | 58 | 59 | 60 |

| | | | |
|---|---|---|---|
| 21 | 22 | | 24 |
| | 32 | | 34 |
| | 42 | | 44 |
| | 52 | 53 | 54 |
| | 62 | | 64 |

| | | | |
|---|---|---|---|
| 84 | 85 | 86 | 87 |
| 94 | | | |
| 104 | | | |
| 114 | 115 | 116 | |

| | | | |
|---|---|---|---|
| 76 | 77 | | |
| 86 | 87 | | |
| 96 | 97 | 98 | 99 |
| 106 | 107 | 108 | 109 |

| | | | |
|---|---|---|---|
| 56 | 57 | 58 | 59 |
| 66 | | | 69 |
| 76 | | | 79 |
| 86 | 87 | 88 | 89 |

| | | | |
|---|---|---|---|
| 42 | 43 | 44 | 45 |
| | 53 | 54 | |
| | | 64 | |
| | | 74 | |

| | | |
|---|---|---|
| 144 | 145 | 146 |
| 154 | 155 | 156 |
| 164 | 165 | 166 |
| 174 | 175 | 176 |
| 184 | 185 | |
| 194 | 195 | |

| | | |
|---|---|---|
| 77 | 78 | 79 |
| 87 | 88 | 89 |
| 97 | 98 | 99 |
| 107 | | 109 |
| 117 | | 119 |

| | | |
|---|---|---|
| 21 | 22 | 23 |
| 31 | 32 | 33 |
| 41 | 42 | 43 |
| | 52 | 53 |

Werkvel 5

# Kombinasies. Vul die ontbrekende getalle in.

Werkvel 8

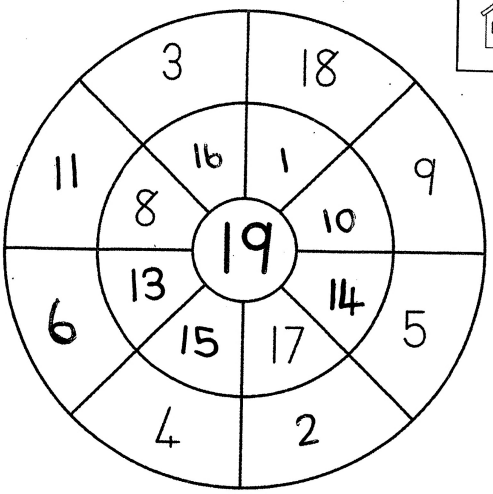


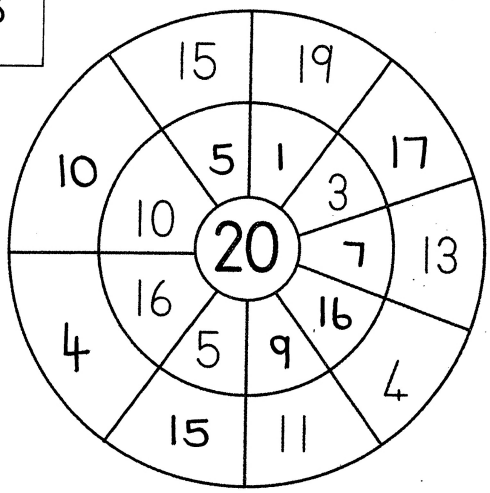


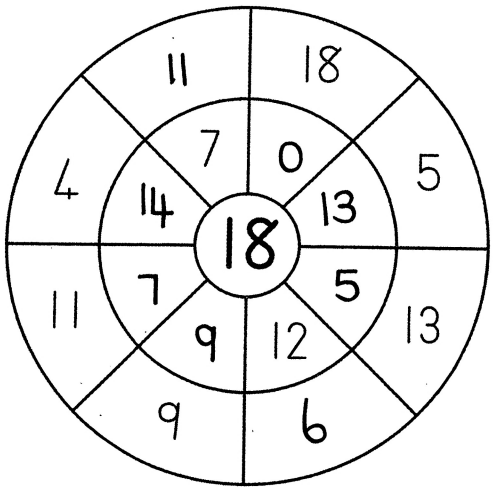


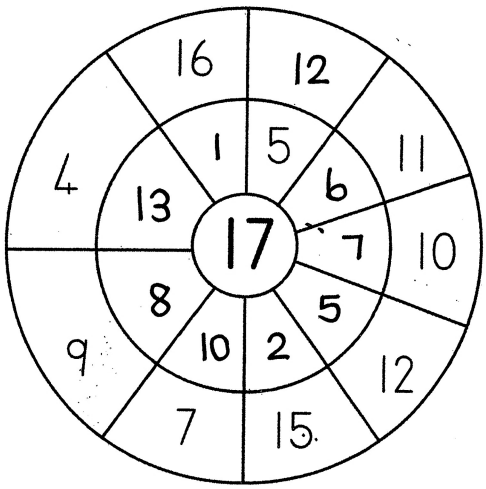


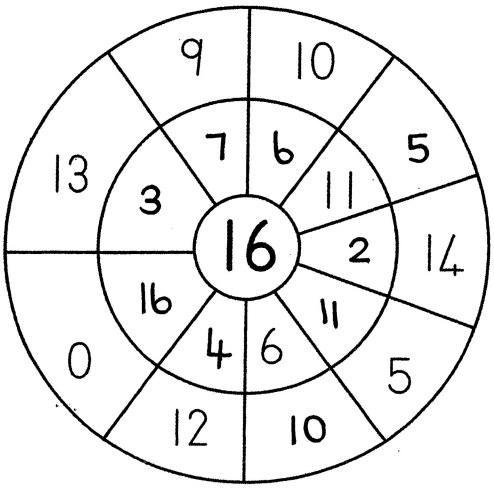


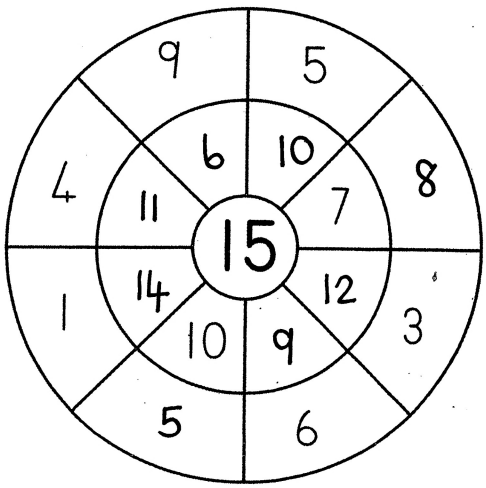

# Digitale tyd oggend

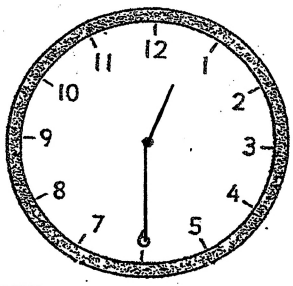

12:30 vm



2:00 vm



4:30 vm



6:00 vm



8:00 vm



9:30 vm

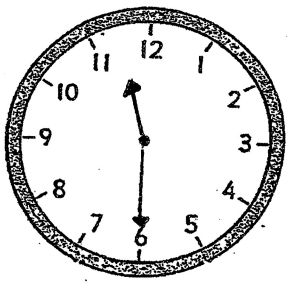

11:30 vm

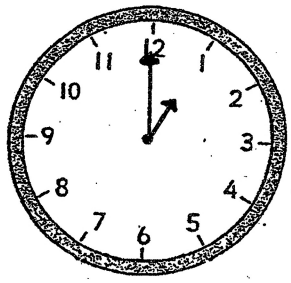

1:00 vm

# Digitale tyd - middag/aand

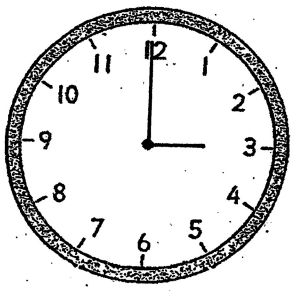

3:00 nm



5:30 nm

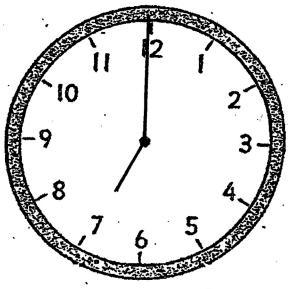

7:00 nm



9:30 nm

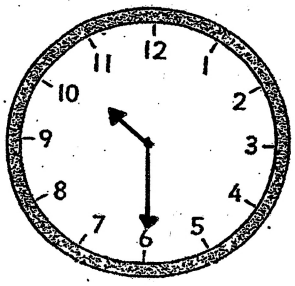

10:30 nm



4:00 nm



5:30 nm



10:00 nm

Werkvel 10

# Werkvel II

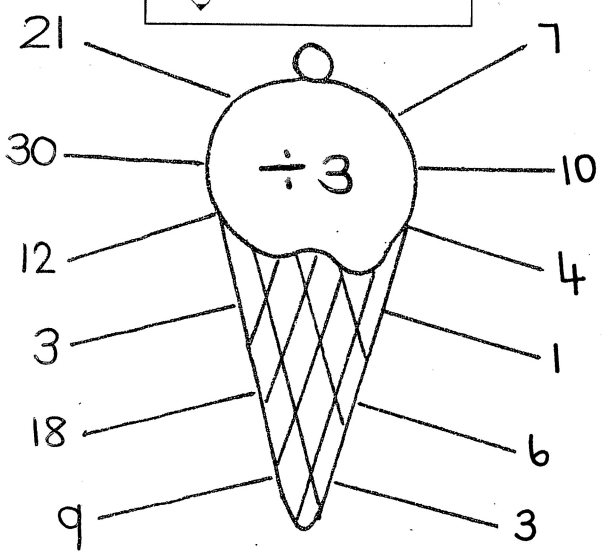
÷ 3
21
30
12
3
18
9
7
10
4
1
6
3

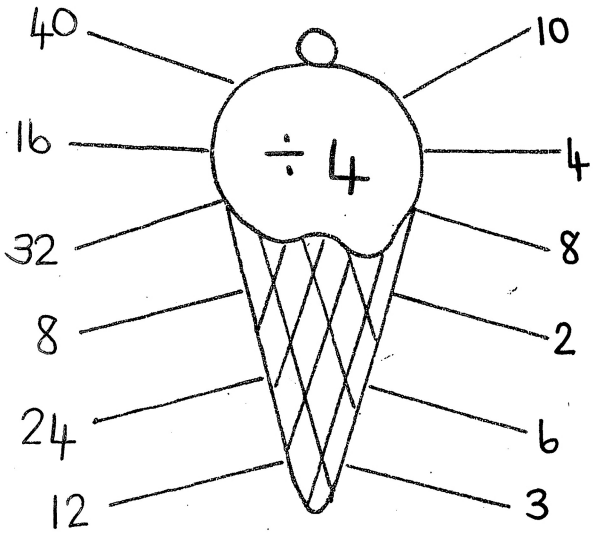
÷ 4
40
16
32
8
24
12
10
4
8
2
6
3

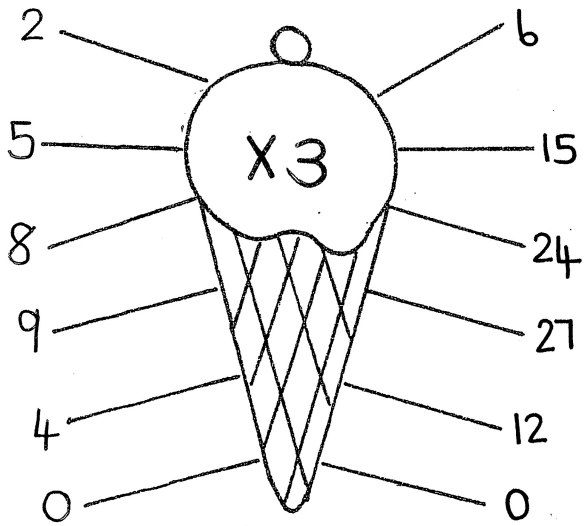
X 3
2
5
8
9
4
0
6
15
24
27
12
0

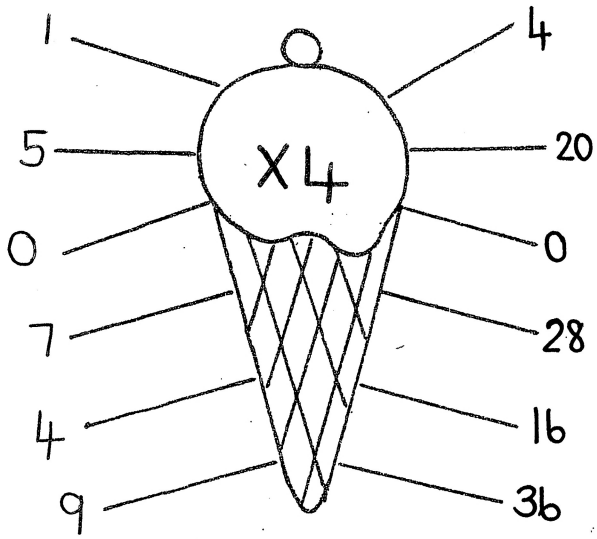
X 4
1
5
0
7
4
9
4
20
0
28
16
36

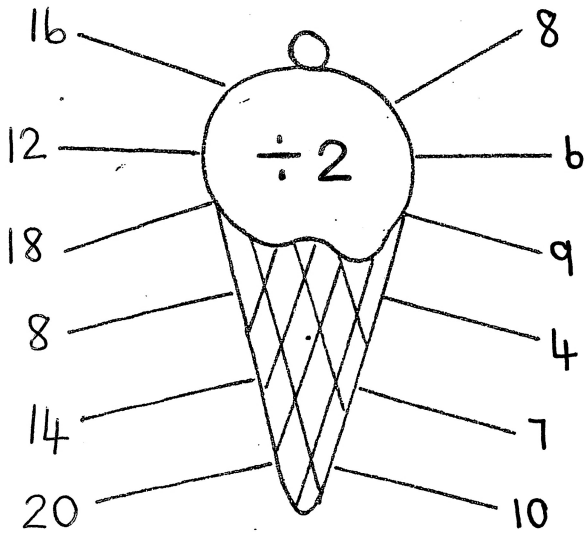
÷ 2
16
12
18
8
14
20
8
6
9
4
7
10

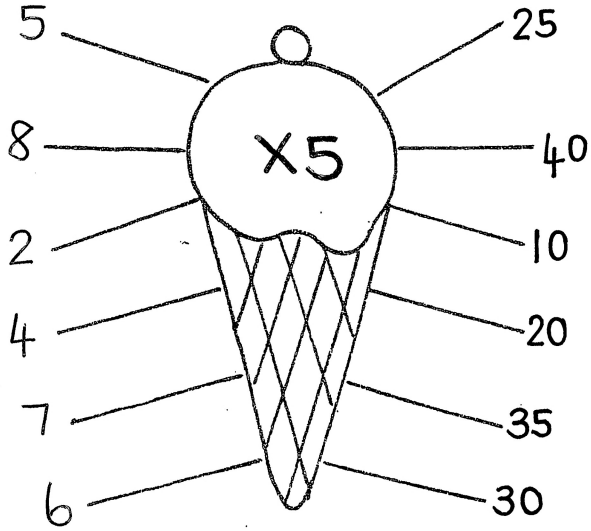
X 5
5
8
2
4
7
6
25
40
10
20
35
30

| Verdubbel | Halveer |
|---|---|
| 42 = 40 + 2<br>80 + 4 = 84 | 86 = 80 + 6<br>40 + 3 = 43 |
| 74 = 70 + 4<br>140 + 8 = 148 | 54 = 50 + 4<br>25 + 2 = 27 |
| 69 = 60 + 9<br>120 + 18 = 138 | 92 = 90 + 2<br>45 + 1 = 46 |
| 95 = 90 + 5<br>180 + 10 = 190 | 38 = 30 + 8<br>15 + 4 = 19 |
| 57 = 50 + 7<br>100 + 14 = 114 | 50 = 50 + 0<br>25 + 0 = 25 |
| 83 = 80 + 3<br>160 + 6 = 166 | 76 = 70 + 6<br>35 + 3 = 38 |
| 38 = 30 + 8<br>60 + 16 = 76 | 64 = 60 + 4<br>30 + 2 = 32 |

Werkvel 12

Werkvel 13

Klanke: -lm

salmdis

rookwalm

valhelm

palmboom

skelmstreek

psalmboek

grashalm

weergalm



Werkvel 16

## Tel in vywe

135 +5 → 140 → 145 → 150 → 155 → 160

90 -5 → 85 → 80 → 75 → 70 → 65

175 -5 → 170 → 165 → 160 → 155 → 150

50 +5 → 55 → 60 → 65 → 70 → 75

## Skryf die getalsimbool

3 tiene en 7 ene 37

4 tiene en 2 ene 42

5 tiene en 0 ene 50

1 tien en 9 ene 19

2 tiene en 1 ene 21

4 tiene en 3 ene 43

3 tiene en 4 ene 34

1 tien en 8 ene 18

| | | | | |
|---|---|---|---|---|
| 116 | | | | |
| 126 | 127 | | | |
| 136 | 137 | 138 | | |
| 146 | 147 | 148 | 149 | |
| 156 | 157 | 158 | 159 | 160 |

| | | | |
|---|---|---|---|
| 184 | 185 | 186 | 187 |
| 194 | | | |
| 204 | | | |
| 214 | 215 | 216 | |

| | | | |
|---|---|---|---|
| 156 | 157 | 158 | 159 |
| 166 | | | 169 |
| 176 | | | 179 |
| 186 | 187 | 188 | 189 |

# Digitale tyd oggend



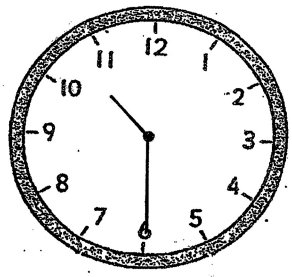
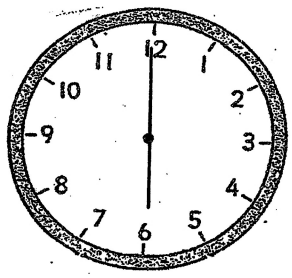

| | | | |
|---|---|---|---|
| 7:30 vm | 3:00 vm | 10:30 vm | 6:00 vm |

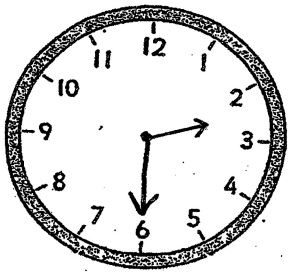


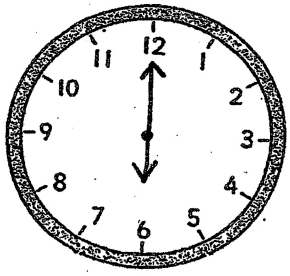

| | | | |
|---|---|---|---|
| 2:30 vm | 4:00 vm | 10:30 vm | 6:00 vm |

# Digitale tyd - middag/aand




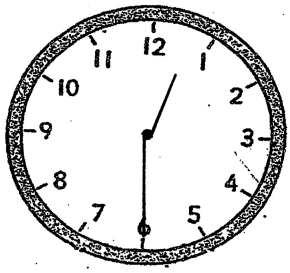

| | | | |
|---|---|---|---|
| 9:00 nm | 4:30 nm | 7:00 nm | 12:30 nm |

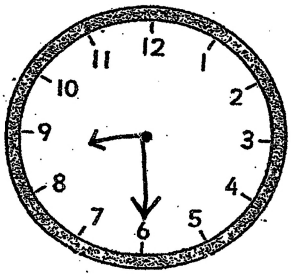


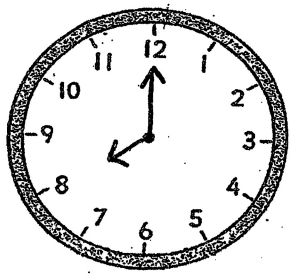

| | | | |
|---|---|---|---|
| 8:30 nm | 3:00 nm | 4:30 nm | 8:00 nm |

Werkvel 17

# Werkvel 18

| | | | |
|---|---|---|---|
| R4,50 | R1,50 | R3,50 | R9.50 |
| R2,50 | R6.50 | R8,50 | R5,50 |

1. Ek koop 'n bal en 'n vissie. Wat kos dit altesaam?
   R2.50 + R6.50
   R2 + R6 → R8 + R1 = R9
2. Ek koop 'n pampoen. Ek betaal met R20. Hoeveel kleingeld kry ek?
   R20 − R5.50
   R20 − R5 → R15 − 50c = R14.50
3. Wat is die verskil tussen die sokkies en die koek se pryse?
   R8.50 − R3.50
   R8.50 − 50c → R8 − R3 = R5
4. Ek koop 'n appel en 'n beer. Ek betaal met R10. Hoeveel kleingeld kry ek? R1.50 + R4.50
   R1 + R4 → R5 + R1 = R6 | R10 − R6 = R4
5. Ek koop 'n hasie en 'n vissie. Wat kos dit altesaam?
   R9.50 + R6.50
   R9 + R6 → R15 + R1 = R16
6. Ek koop 'n appel. Ek betaal met R5. Hoeveel kleingeld kry ek?
   R5 − R1.50
   R5 − R1 → R4 − 50c = R3.50
7. Ek het R9. Watter 2 goed kan ek koop?
   Enige 2 items wat saam R9 / minder kos.

## Werkvel 19

Klanke: -rt

| | |
|---|---|
| Gert | Maartmaand |
| tertkors | gortsop |
| kortbroek | padkaart |
| sportsak | pikswart |
| houtfort | stortkop |
| kwartnoot | katstert |

## Werkvel 20

Phonics: -at

| | |
|---|---|
| cat | mat |
| fat | hat |
| bat | what |
| pat | sat |

$6 + 2 + \boxed{2} = 10$

$8 + \boxed{0} + 3 = 11$

$\boxed{5} + 4 + 3 = 12$

$5 + 3 + \boxed{5} = 13$

$1 + \boxed{13} + 0 = 14$

$\boxed{13} + 1 + 1 = 15$

$3 + 0 + \boxed{13} = 16$

$5 + \boxed{10} + 2 = 17$

$\boxed{12} + 3 + 3 = 18$

$2 + 5 + \boxed{12} = 19$

$20 - 4 - \boxed{9} = 7$

$18 - 8 - 2 = \boxed{8}$

$16 - 4 - \boxed{4} = 8$

$14 - \boxed{6} - 2 = 6$

$12 - 3 - 1 = \boxed{8}$

$19 - 5 - \boxed{12} = 2$

$17 - \boxed{5} - 3 = 9$

$15 - 3 - 2 = \boxed{10}$

$13 - 6 - \boxed{2} = 5$

$11 - \boxed{1} - 7 = 3$

Werkvel 21

# Digitale tyd - middag/aand

Werkvel 24

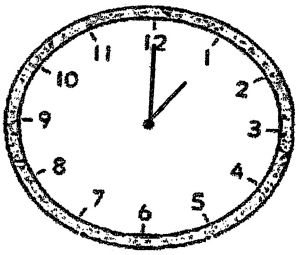
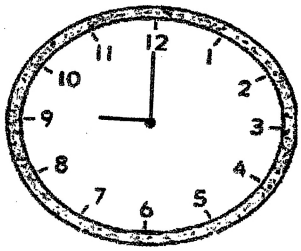
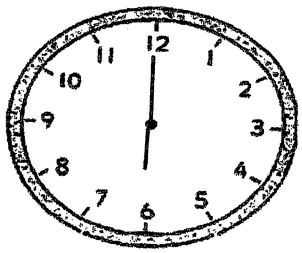
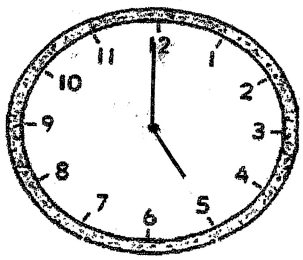

| | | | |
|---|---|---|---|
| 1:00 nm | 9:00 nm | 6:00 nm | 5:00 nm |

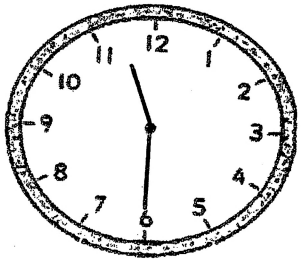
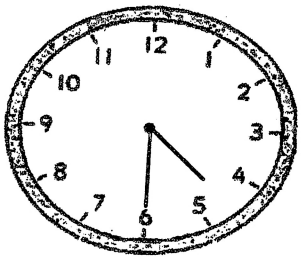
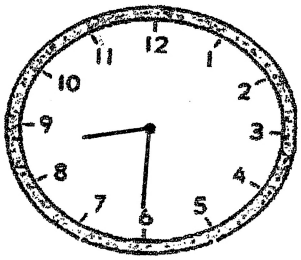
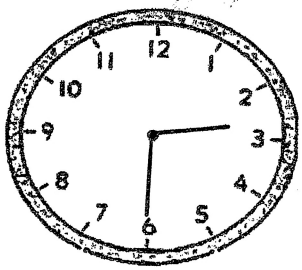

| | | | |
|---|---|---|---|
| 11:30 nm | 4:30 nm | 8:30 nm | 2:30 nm |

# Digitale tyd oggend

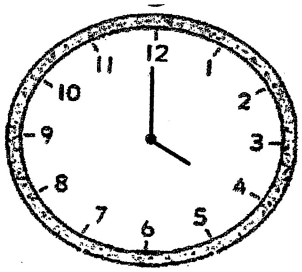
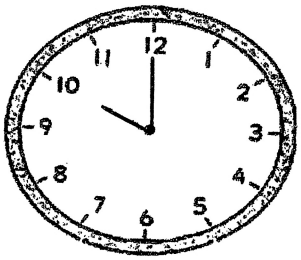
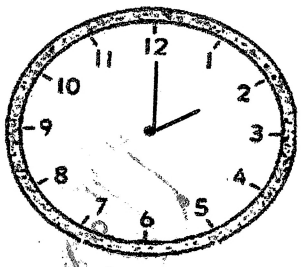
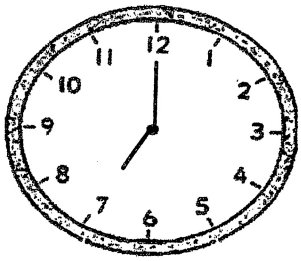

| | | | |
|---|---|---|---|
| 4:00 vm | 10:00 vm | 2:00 vm | 7:00 vm |

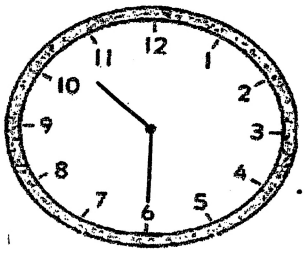
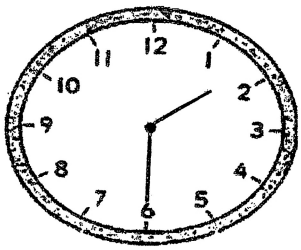
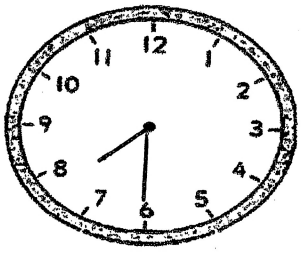
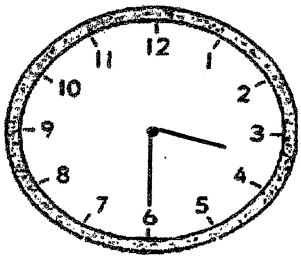

| | | | |
|---|---|---|---|
| 10:30 vm | 1:30 vm | 7:30 vm | 3:30 vm |

# Spinnekopsomme

**Help Jaco om hierdie spinnekopsomme te doen. Jaco het die eerste twee vir jou gedoen sodat jy kan sien wat om te doen.**

Werkvel 25

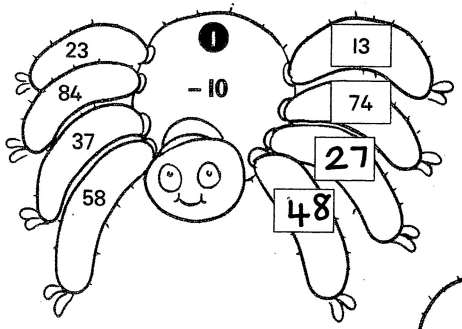


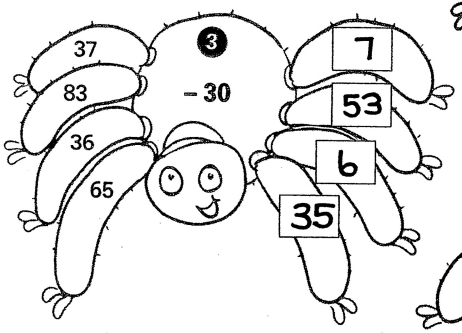


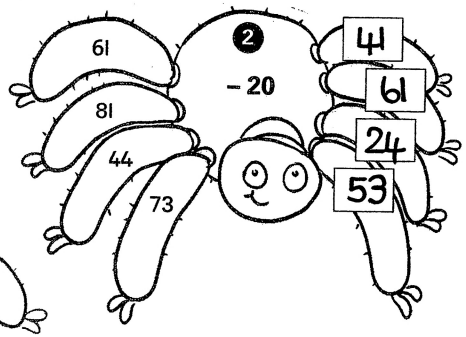


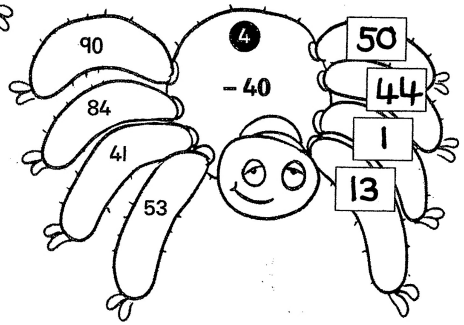


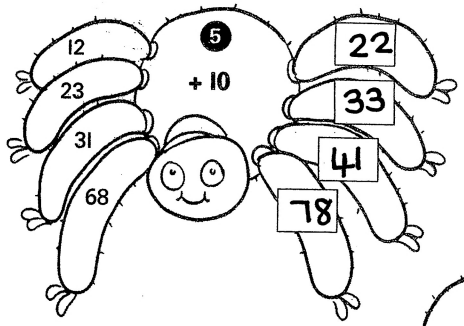


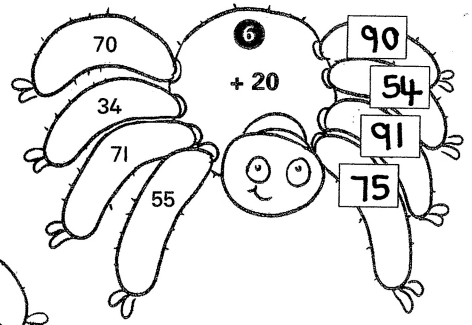


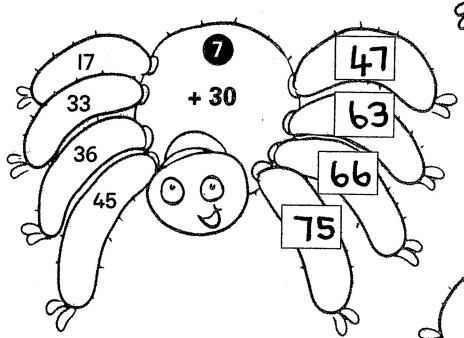


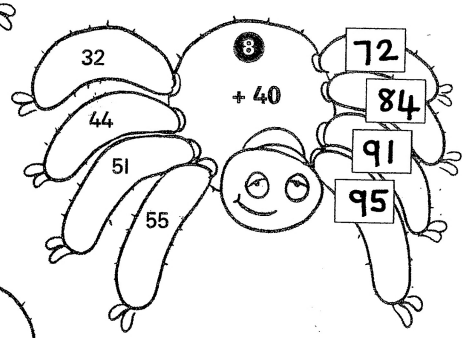


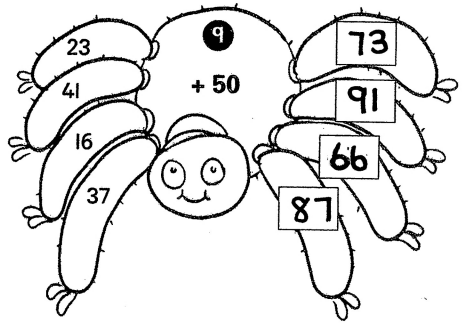

# Werkvel 26

1. Ontwerp 'n patroon waar jy in tweë(2) tel en jy begin by 14.

| | | | | | | | |
|---|---|---|---|---|---|---|---|
| 14 | 16 | 18 | 20 | 22 | 24 | 26 | 28 |
| OF: 14 | 12 | 10 | 8 | 6 | 4 | 2 | 0 |

2. Verduidelik wat gebeur in hierdie patroon: 2 4 6 8 10 12

Tel aan in 2.

3. Tel terug in vywe(5). Begin by 95.

95 90 85 80 75 70 65 60

4. Voltooi die volgende patroon:

15 18 21 24 27 30 33 36 39 42

5. Ontwerp 'n patroon waar jy terugtel in tiene(10).

_____ _____ _____ _____ _____ _____ _____ _____

6. Verduidelik wat gebeur in hierdie patroon: 18 15 12 9 6 3

Tel terug in 3.

7. Voltooi die volgende patroon:

26 30 34 38 42 46 50 54 58 62

## Werkvel 27

Klanke: -ts

ratsheid

rotstuin

klitsgras

gepiets

gebots

klasmaats

bergfiets

## Werkvel 28

Phonics: -am

dam

Pam

am

jam

Sam

ham

mam

ram



# Vermenigvuldiging

# Voltooi die somme

Werkvel 29

×2

5 7 3 10 14 6

×5

4 7 5 20 35 25

×10

6 1 7 60 10 70

×2

6 8 2 12 16 4

×3

3 5 7 9 15 21

×4

6 2 1 24 8 4

×5

8 3 10 40 15 50

×3

4 2 5 12 6 15

# Werkvel 31

1. Vul die digitale tyd in die <u>oggend</u> in.

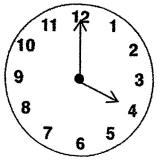

4:00 vm



9:30vm

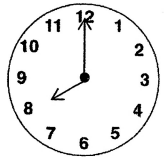

8:00vm

2. Vul die digitale tyd in die <u>namiddag/aand</u> in.

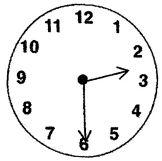

2:30nm

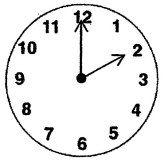

2:00 nm

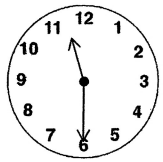

11:30 nm

3. Teken die wysers op die horlosies in.



1:00vm



4:30 vm



11:00vm



8:30 nm



10:30 nm

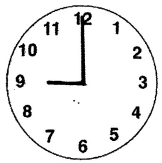

9:00nm

1. Sê of elkeen van die volgende 'n *bal*, *boks* of *silinder* is.

| | | | |
|---|---|---|---|
| 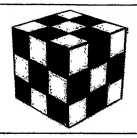 |  |  | |
| boks | bal | silinder | bal |

2. Kleur in: balle = blou; silinders = geel; bokse = oranje (los die res)

| | | | |
|---|---|---|---|
|  oranje | 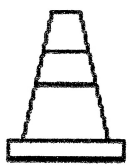 |  | oranje |
| geel 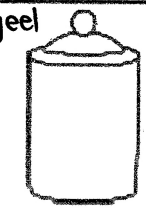 | oranje |  oranje | blou |
|  oranje | geel | oranje | geel  |
| | oranje | (blou) 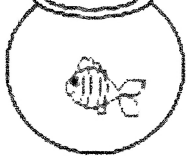 | blou  |

# Werkvel 32

1. Ontwerp 'n patroon waar jy in drieë(3) terug tel en jy begin by 42.

42 39 36 33 30 27 24 21

2. Verduidelik wat gebeur in hierdie patroon: 28, 25, 22, 19, 16, 13

Tel terug in 3.

3. Tel in vywe(5) van 35 tot 70.

35 40 45 50 55 60 65 70

4. Voltooi die volgende patroon:

64 68 72 76 80 84 88 92 96 100

5. Ontwerp 'n patroon waar jy aantel in viere(4). Begin by 128.

128 132 136 140 144 148 152 156

6. Verduidelik wat gebeur in hierdie patroon: 36, 40, 44, 48, 52

Tel aan in 4.

7. Voltooi en brei die patrone uit waar nodig.

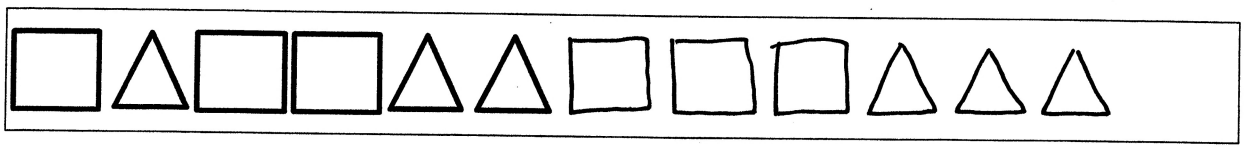

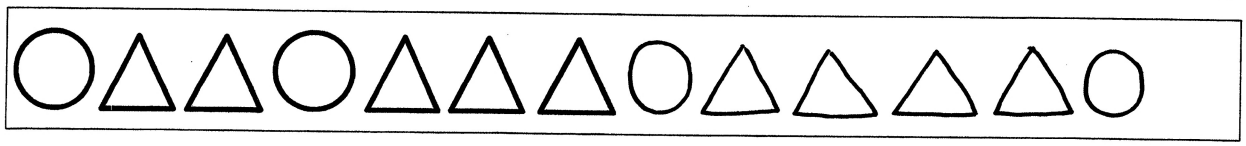

8. Ontwerp nou jou eie groeiende patroon met vierkante en sirkels.

groeinde patroon → vierkante + sirkels

# Werkvel 33

| | | | | | | | |
|---|---|---|---|---|---|---|---|
| 12 | 15 | 18 | 21 | 24 | 27 | 30 | 33 |
| 40 | 45 | 50 | 55 | 60 | 65 | 70 | 75 |
| 32 | 30 | 28 | 26 | 24 | 22 | 20 | 18 |
| 40 | 36 | 32 | 28 | 24 | 20 | 16 | 12 |
| 37 | 47 | 57 | 67 | 77 | 87 | 97 | 107 |



$\frac{2}{4}$ $\left(\frac{1}{2}\right)$

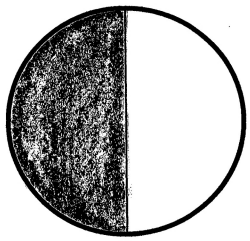

$\frac{1}{2}$



$\frac{2}{3}$



$\frac{3}{5}$

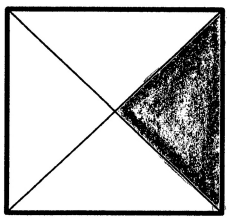

$\frac{1}{4}$

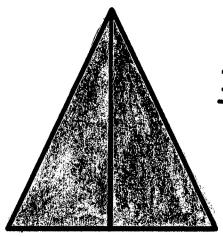

$\frac{2}{2}$ $(1)$

## Werkvel 34

Klanketoets

dunderm

gortsop

byswerm

sportsak

valskerm

salmdis

klasmaats

palmboom

gepiets

weergalm

## Werkvel 35

Phonics test

there

thick

bath

fat

mam

this

they

sat

ham

ram

| Kombinasies van 18 en 19 | Tafels | Halveer en verdubbel |
|---|---|---|
| 17 + 2 = 19 | 2 × 6 = 12 | helfte van 80 is 40 |
| 5 + 13 = 18 | 3 × 3 = 9 | 12 verdubbel is 24 |
| 14 + 5 = 19 | 4 × 2 = 8 | helfte van 16 is 8 |
| 7 + 11 = 18 | 5 × 1 = 5 | 24 verdubbel is 48 |
| 8 + 11 = 19 | 10 × 3 = 30 | helfte van 26 is 13 |
| 16 + 2 = 18 | 2 × 8 = 16 | 31 verdubbel is 62 |
| 10 + 9 = 19 | 4 × 3 = 12 | helfte van 42 is 21 |
| 7 + 11 = 18 | 3 × 4 = 12 | 43 verdubbel is 86 |
| 10 + 9 = 19 | 10 × 0 = 0 | helfte van 48 is 24 |
| 8 + 10 = 18 | 5 × 2 = 10 | 50 verdubbel is 100 |
| 8 + 11 = 19 | 3 × 5 = 15 | helfte van 62 is 31 |
| 8 + 10 = 18 | 4 × 4 = 16 | 17 verdubbel is 34 |
| 17 + 2 = 19 | 2 × 10 = 20 | helfte van 50 is 25 |
| 1 + 17 = 18 | 10 × 4 = 40 | 26 verdubbel is 52 |
| 1 + 18 = 19 | 5 × 3 = 15 | helfte van 58 is 29 |

15 15 15

Vul jou telling in. Daar is 15 somme in elke kolom. Hoeveel het jy reg gekry?